Finding Angles within Shapes

Name:

Count the number of Acute, Obtuse, Right and Reflex angles in each shape.

Ex)

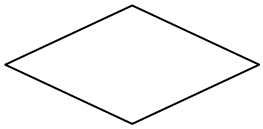

1)

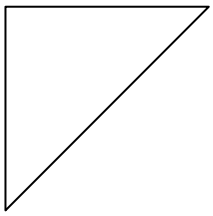

2)



3)

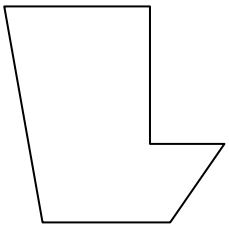

4)

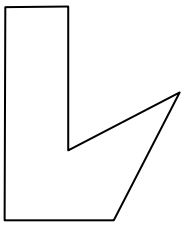

5)



6)

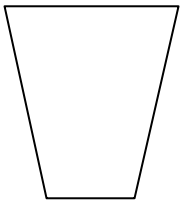

7)

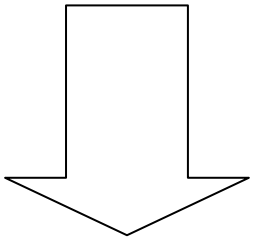

8)

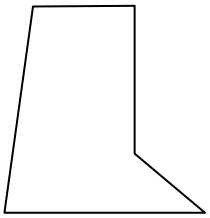

9)

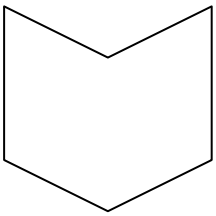

10)

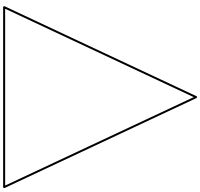

11)

Answers

Ex.	2	2	0	0
1.				
2.				
3.				
4.				
5.				
6.				
7.				
8.				
9.				
10.				
11.				

Finding Angles within Shapes

Name: **Answer Key**

Count the number of Acute, Obtuse, Right and Reflex angles in each shape.

Ex)

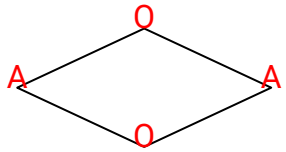

1)

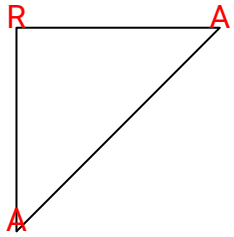

2)

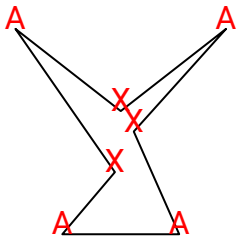

3)

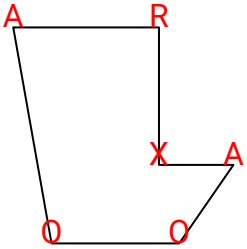

4)

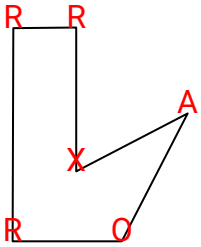

5)

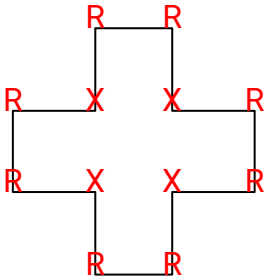

6)

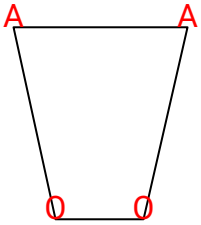

7)

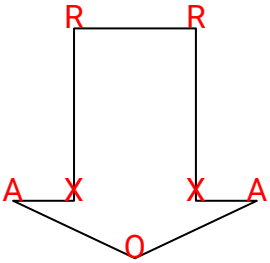

8)

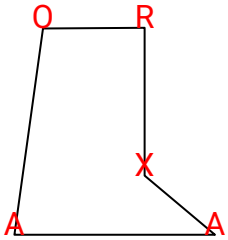

9)

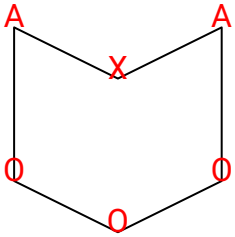

10)

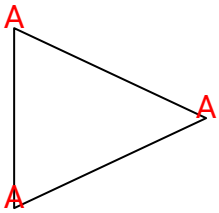

11)



Answers

Ex.	2	2	0	0
1.	2	0	1	0
2.	4	0	0	3
3.	2	2	1	1
4.	1	1	3	1
5.	0	0	8	4
6.	2	2	0	0
7.	2	1	2	2
8.	2	1	1	1
9.	2	3	0	1
10.	3	0	0	0
11.	0	0	4	0