# Dividing with a Numberline

Name:

**Use the numberline to solve each problem.**

**1)** 6÷3=

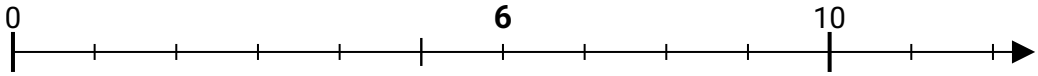


**2)** 20÷10=

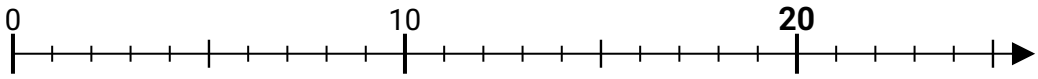


**3)** 36÷9=

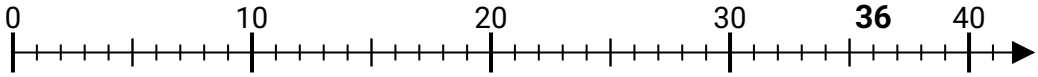


**4)** 40÷10=

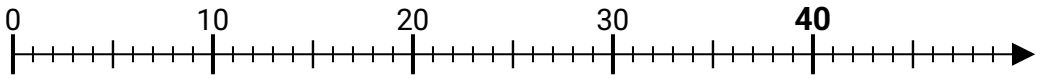


**5)** 10÷5=

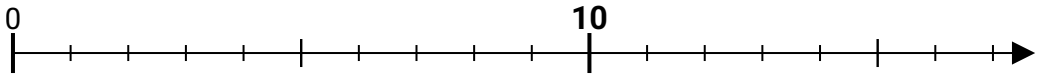


**6)** 8÷4=

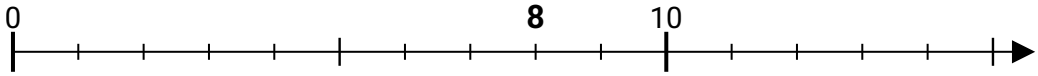


**7)** 30÷6=

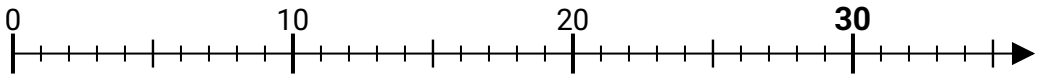


**8)** 18÷9=

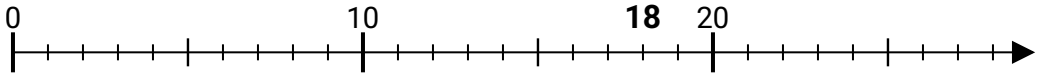


**9)** 45÷9=

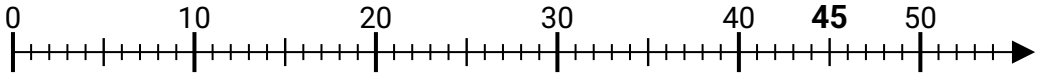


**10)** 40÷8=

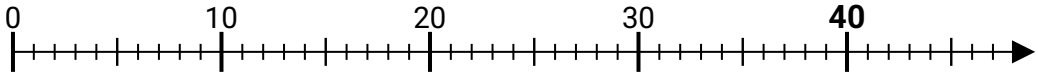


**11)** 12÷6=

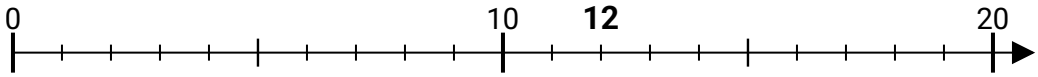


## Answers

1. _____
2. _____
3. _____
4. _____
5. _____
6. _____
7. _____
8. _____
9. _____
10. _____
11. _____



| | | | | | | | | | | |
|---|---|---|---|---|---|---|---|---|---|---|
| 1-10 | 91 | 82 | 73 | 64 | 55 | 45 | 36 | 27 | 18 | 9 |
| 11 | 0 | | | | | | | | | |

Dividing with a Numberline

Name: **Answer Key**

**Use the numberline to solve each problem.**

**1)** 6÷3=

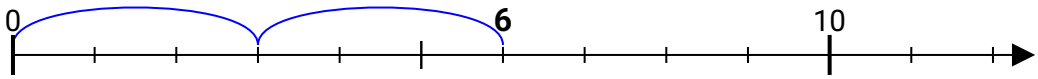


**2)** 20÷10=

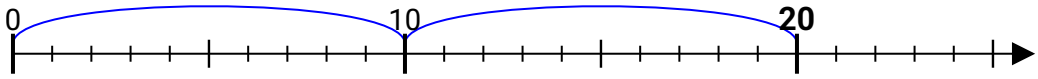


**3)** 36÷9=

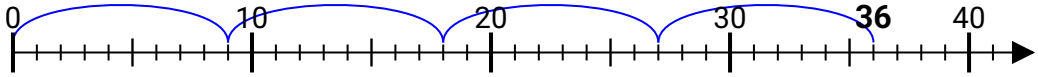


**4)** 40÷10=

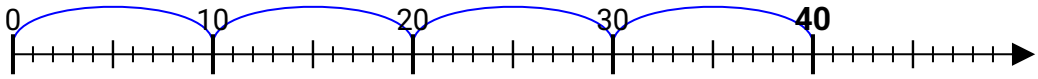


**5)** 10÷5=

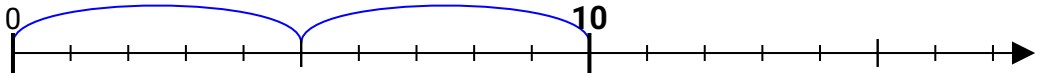


**6)** 8÷4=

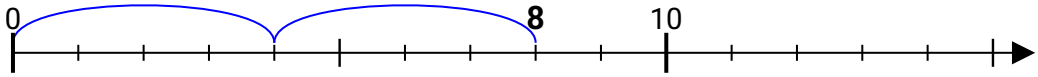


**7)** 30÷6=

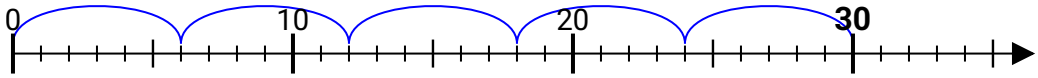


**8)** 18÷9=

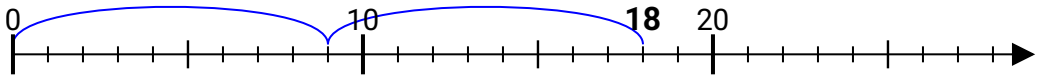


**9)** 45÷9=

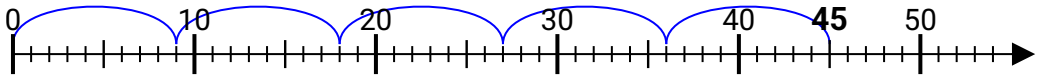


**10)** 40÷8=

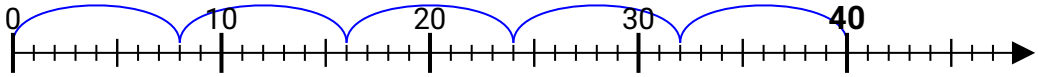


**11)** 12÷6=

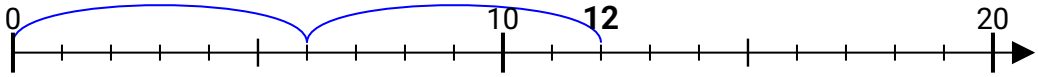


**Answers**

1. 2
2. 2
3. 4
4. 4
5. 2
6. 2
7. 5
8. 2
9. 5
10. 5
11. 2