Rewriting Multiplication Problems (visual)

Name:

Write each array as a multiplication problem and solve.

Ex)

1)

2)

3)



4)

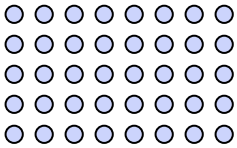

5)



6)

7)

8)

9)



10)



11)

Answers

Ex. **3 × 9 = 27**

1. _____
2. _____
3. _____
4. _____
5. _____
6. _____
7. _____
8. _____
9. _____
10. _____
11. _____

1-10	91	82	73	64	55	45	36	27	18	9
11	0									

Rewriting Multiplication Problems (visual) Name: **Answer Key**

Write each array as a multiplication problem and solve.

Ex)

1)

2)

3) 

4) 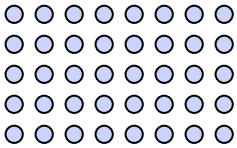

5) 

6)

7)

8)

9) 

10) 

11)

Answers

Ex. **3 × 9 = 27**

1. **4 × 2 = 8**
2. **10 × 3 = 30**
3. **6 × 8 = 48**
4. **5 × 8 = 40**
5. **7 × 6 = 42**
6. **3 × 4 = 12**
7. **5 × 3 = 15**
8. **9 × 7 = 63**
9. **6 × 6 = 36**
10. **9 × 10 = 90**
11. **6 × 2 = 12**

1-10	91	82	73	64	55	45	36	27	18	9
11	0									