Function Machines (Add & Subtract)

Name:

Determine the rule each function machine is using.

Ex)

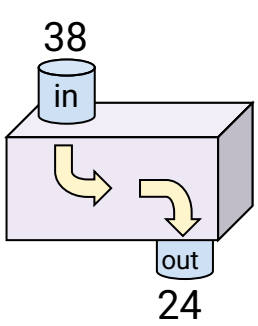

Subtract 14

1)

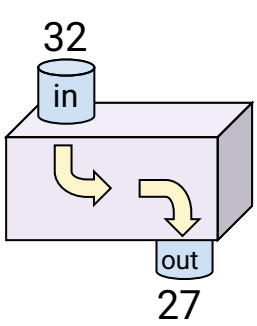

2)

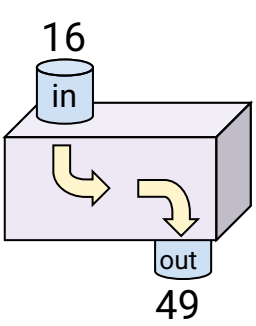

3)

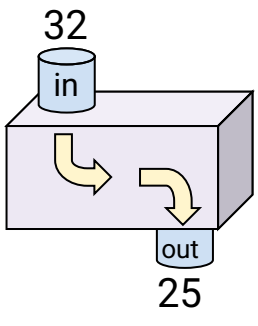

4)

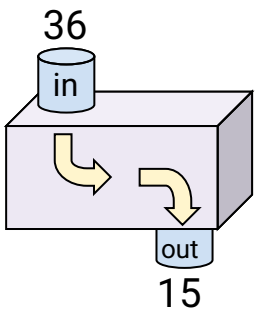

5)

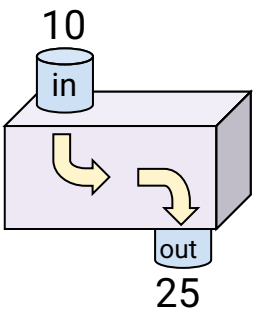

6)

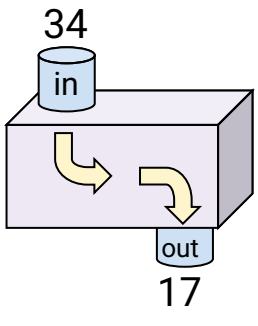

7)

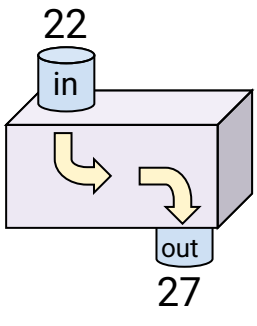

8)

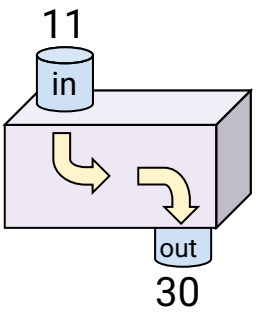

9)

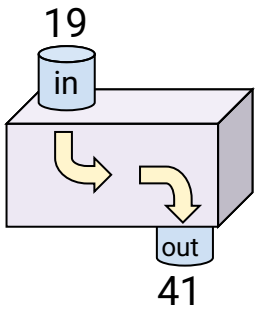

10)

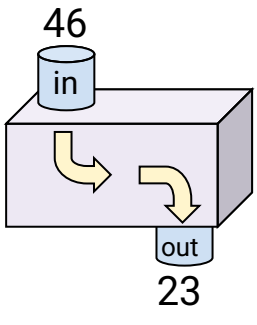

11)

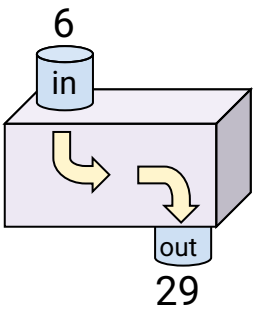

Answers

Ex. Subtract 14

1. _____
2. _____
3. _____
4. _____
5. _____
6. _____
7. _____
8. _____
9. _____
10. _____
11. _____

Function Machines (Add & Subtract) Name: **Answer Key**

Determine the rule each function machine is using.

Ex)

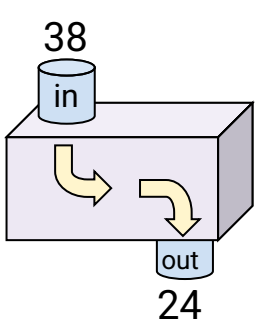

Subtract 14

1)

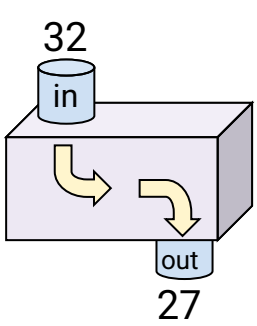

Subtract 5

2)

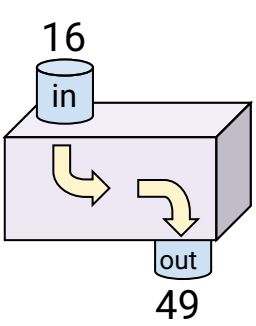

Add 33

3)

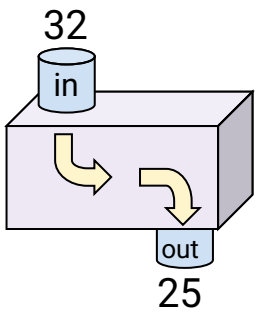

Subtract 7

4)

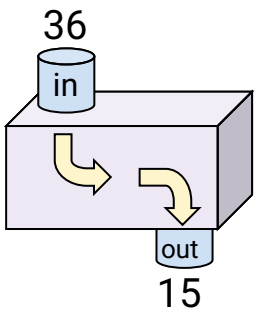

Subtract 21

5)

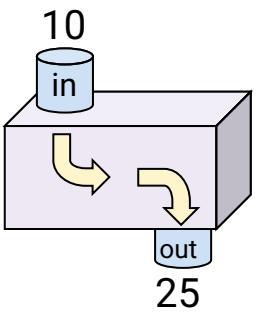

Add 15

6)

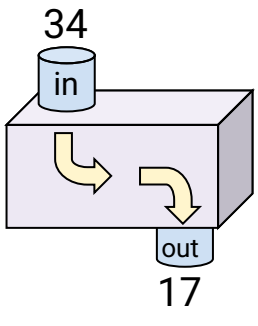

Subtract 17

7)

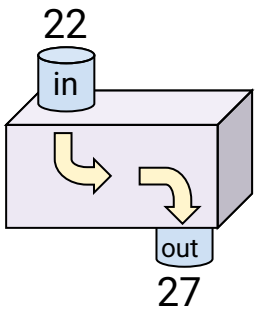

Add 5

8)

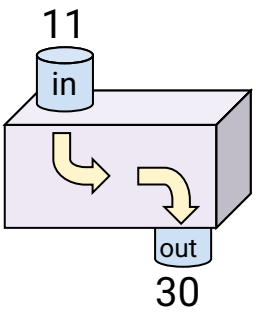

Add 19

9)

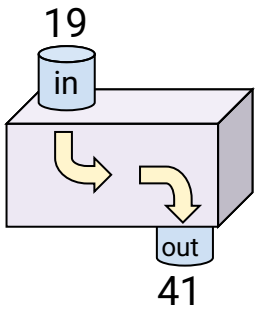

Add 22

10)

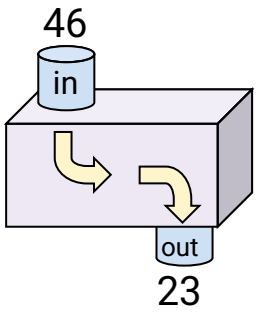

Subtract 23

11)

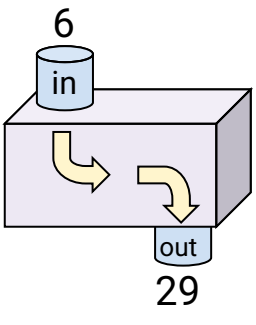

Add 23

Answers

Ex.	Subtract 14
1.	Subtract 5
2.	Add 33
3.	Subtract 7
4.	Subtract 21
5.	Add 15
6.	Subtract 17
7.	Add 5
8.	Add 19
9.	Add 22
10.	Subtract 23
11.	Add 23